GLEICH

Umkehrung | 7

Gleiche die Seiten aus.

Zeichne, zähle dazu.

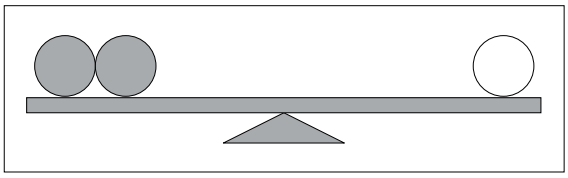

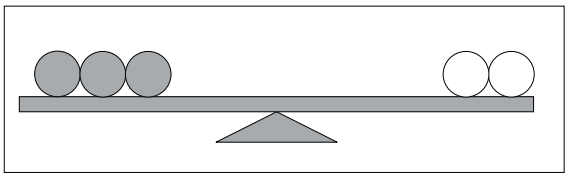

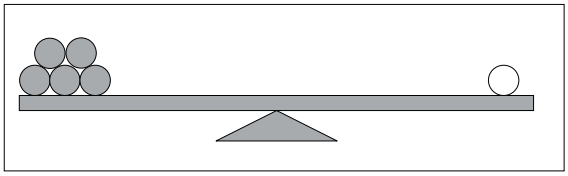

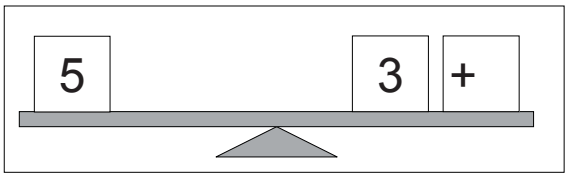

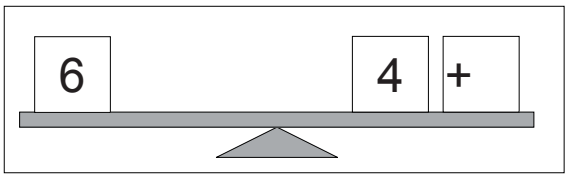

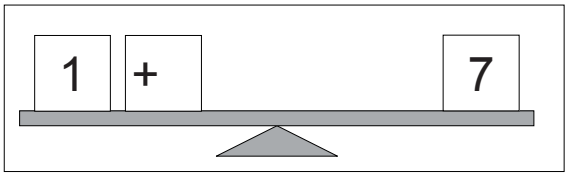

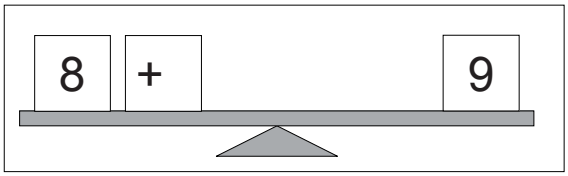

Streiche oder nimm weg.

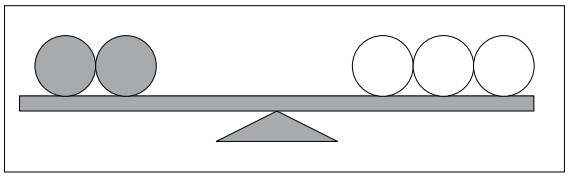

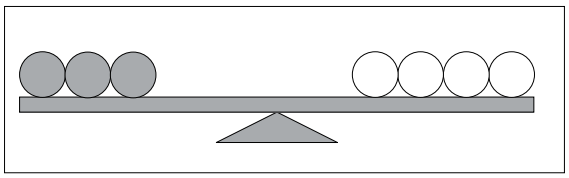

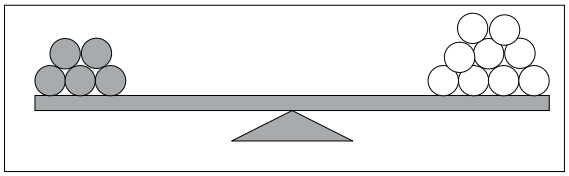

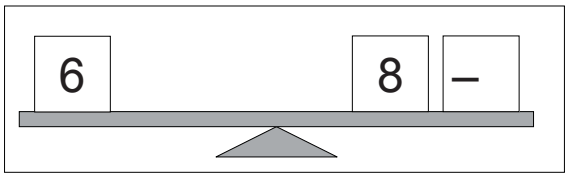

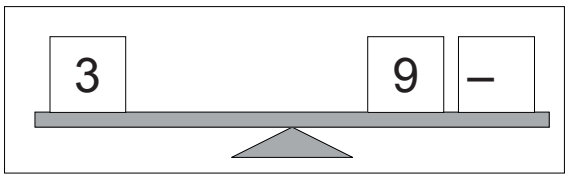

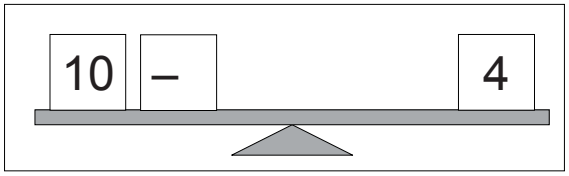

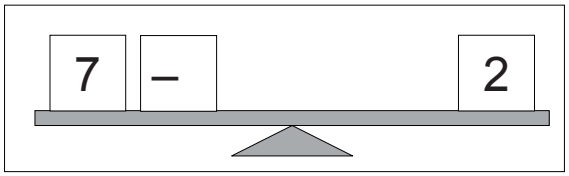

BERGE

Addition / Subtraktion 29

Suche die fehlenden Zahlen.
Mache die Kontrolle.

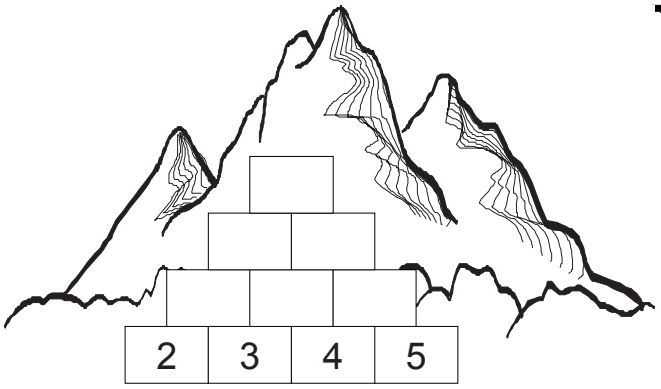

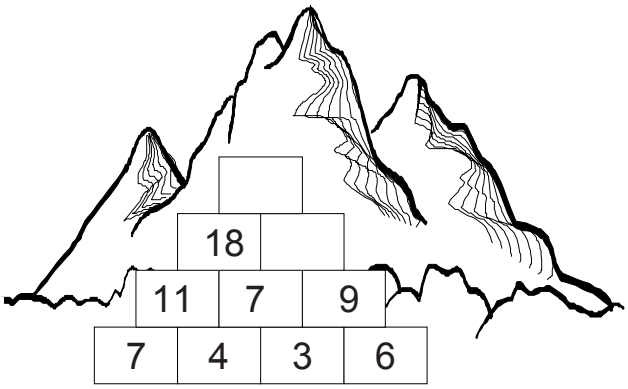

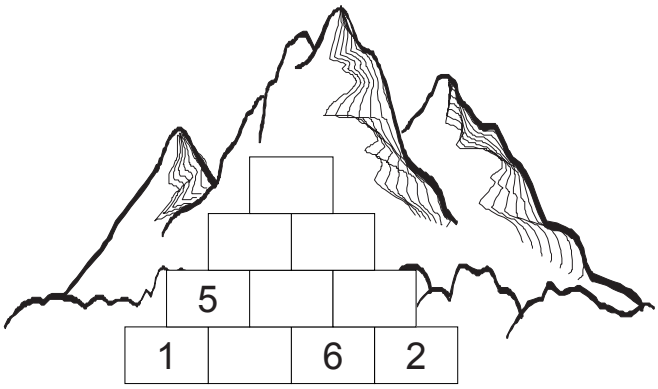

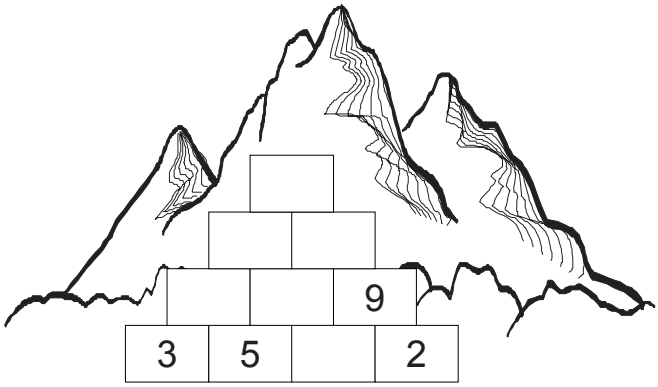

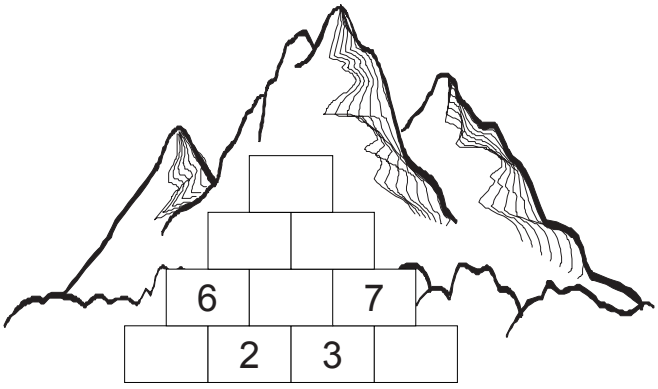

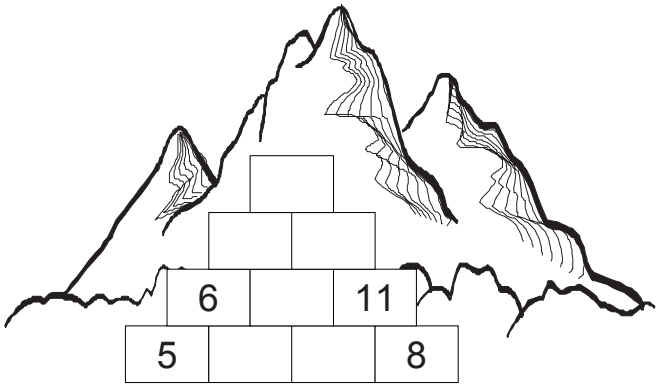

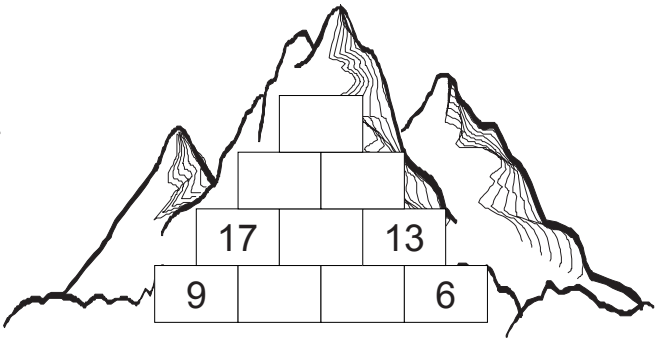

GLEICHE SEITEN / 2

Umkehrung

42

1. 80 = 20 + ☐
30 = 10 + ☐
50 = 40 + ☐
70 = 20 + ☐

2. 60 = 30 + ☐
80 = 10 + ☐
90 = 30 + ☐
70 = 30 + ☐

3. 40 = 30 + ☐
70 = 50 + ☐
30 = 20 + ☐
60 = 40 + ☐

4. 50 = 10 + ☐
60 = 20 + ☐
90 = 20 + ☐
50 = 50 + ☐

5. 60 = 10 + ☐
70 = 10 + ☐
50 = 30 + ☐
40 = 10 + ☐

6. 80 = 60 + ☐
90 = 30 + ☐
60 = 50 + ☐
90 = 10 + ☐

7. 80 = 30 + ☐
40 = 20 + ☐
80 = 20 + ☐
60 = 40 + ☐

8. 40 = 10 + ☐
60 = 60 + ☐
70 = 10 + ☐
50 = 40 + ☐

9. 90 = 80 + ☐
70 = 40 + ☐
80 = 10 + ☐
20 = 20 + ☐

DIE UHR / 1

Stunden

77

Zeichne die Uhrzeit ein.

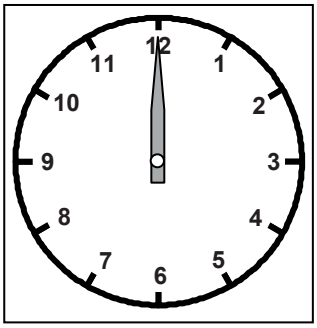

ein Uhr

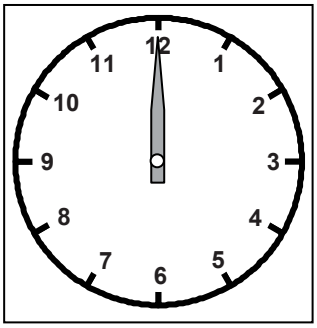

sieben Uhr

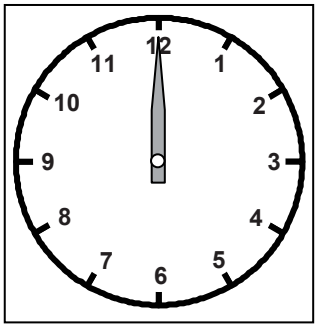

zwölf Uhr

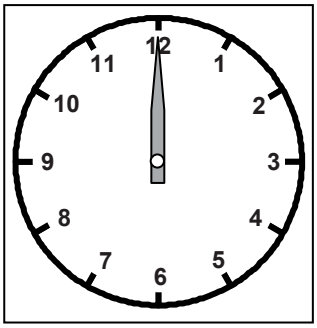

drei Uhr

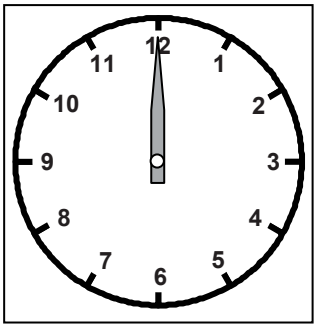

elf Uhr

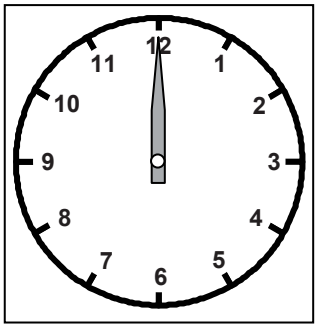

zwei Uhr

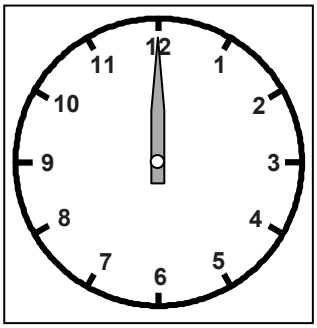

acht Uhr

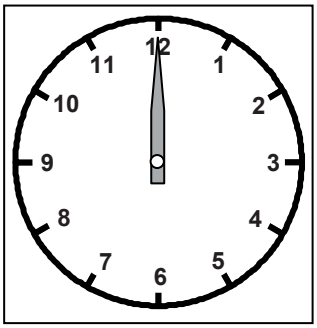

fünf Uhr

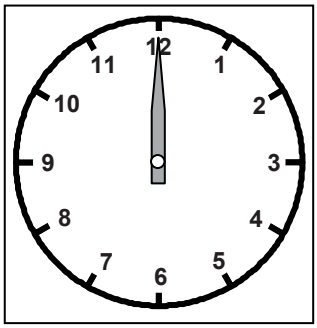

zehn Uhr

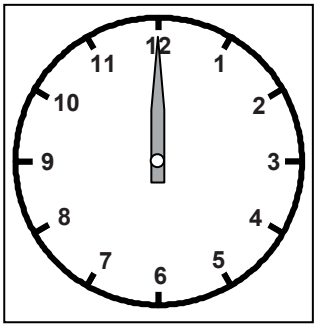

vier Uhr

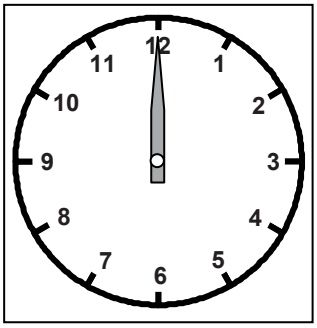

neun Uhr

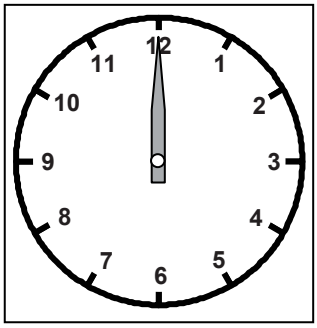

sechs Uhr